EVS

1. Make a hanging project on the means of transport. (This project is a part of '**Subject Enrichment**' for the Half Yearly Examination.)

Roll no. 1 to 8	-	Land transport
Roll no. 9 to 18	-	Water transport
Roll no. 19 to 27	-	Air transport

NH-1, G.T.Road, Ikolahi, Khanna-141401
Ph.: +91-01628-231700,701 & +91-8427119747
e-mail : dpskhanna@gmail.com
Website: www.dpskhanna.com

Delhi Public School Khanna

KHANNA

Affiliated to CBSE

Holiday Assignment

2017-18

Class - I

A task deputed is a mission entrusted

Denzil Solomon

English

Section - A

1. See, read, draw and colour.

Ice-cream	**Hut**
Tree	**Ball**
Flag	**Apple**
Kite	**Glass**

2. Fill in the blanks using ‘a’ or ‘an’.

a. ……..…… parrot.

b. ……..…… eraser.

c. ……..…… nose.

d. ……..…… owl.

e. ……..…… telephone.

f. ……..…… house.

g. ……..…… umbrella.

22. Answer the following:

a. Which day comes just after Thursday?

…….....

b. How many months are there in a year?

…….....

23. Solve:

a. The figure is made up of how many circles?



…….

b. Name the shape of the shaded part.

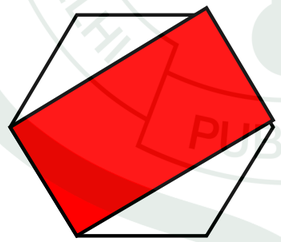

…….

c.

……. …….

21. Join the dots and colour the picture:

3. Complete the sentences using ‘is’ ‘am’ or ‘are’.

a. The boy…….……. lazy.

b. Ants……..…… always busy.

c. The dog……..…… under the table.

d. The girl……..…… on the computer.

e. You……..…… very kind to me.

f. I……..…… tired.

g. We……..…… happy.

h. I……..…… a boy.

4. Use ‘this’ or ‘that’ to complete sentences.

a. ……. is a flower.

b. ……. is my house.

c. ……. boy is my brother.

d. ……. is a leaf.

e. ……. is my pencil.

f. ……. is my school.

h. ……. is a cup.

g. ……. is a cat.

5. Colour the boxes and match with their names.

- Red
- Green
- Yellow
- Black
- Pink
- Blue
- Orange
- Purple

6. Match the names which go along with occupation.

- Doctor
- Teacher
- Gardener
- Driver
- Carpenter
- Chef

7. Write names of fruits and draw their pictures.

a .....

b .....

c .....

d .....

e .....

f .....

g .....

20. Look at the picture and fill in the blank.

a. There are …….. people in the park.

b. There are ……. trees in the park.

c. There are …….... animals in the park.

d. There are ……. flowers in the park.

e. ……... aeroplane is flying in the sky.

19. Help the chicks to find their way back to their mother hen.

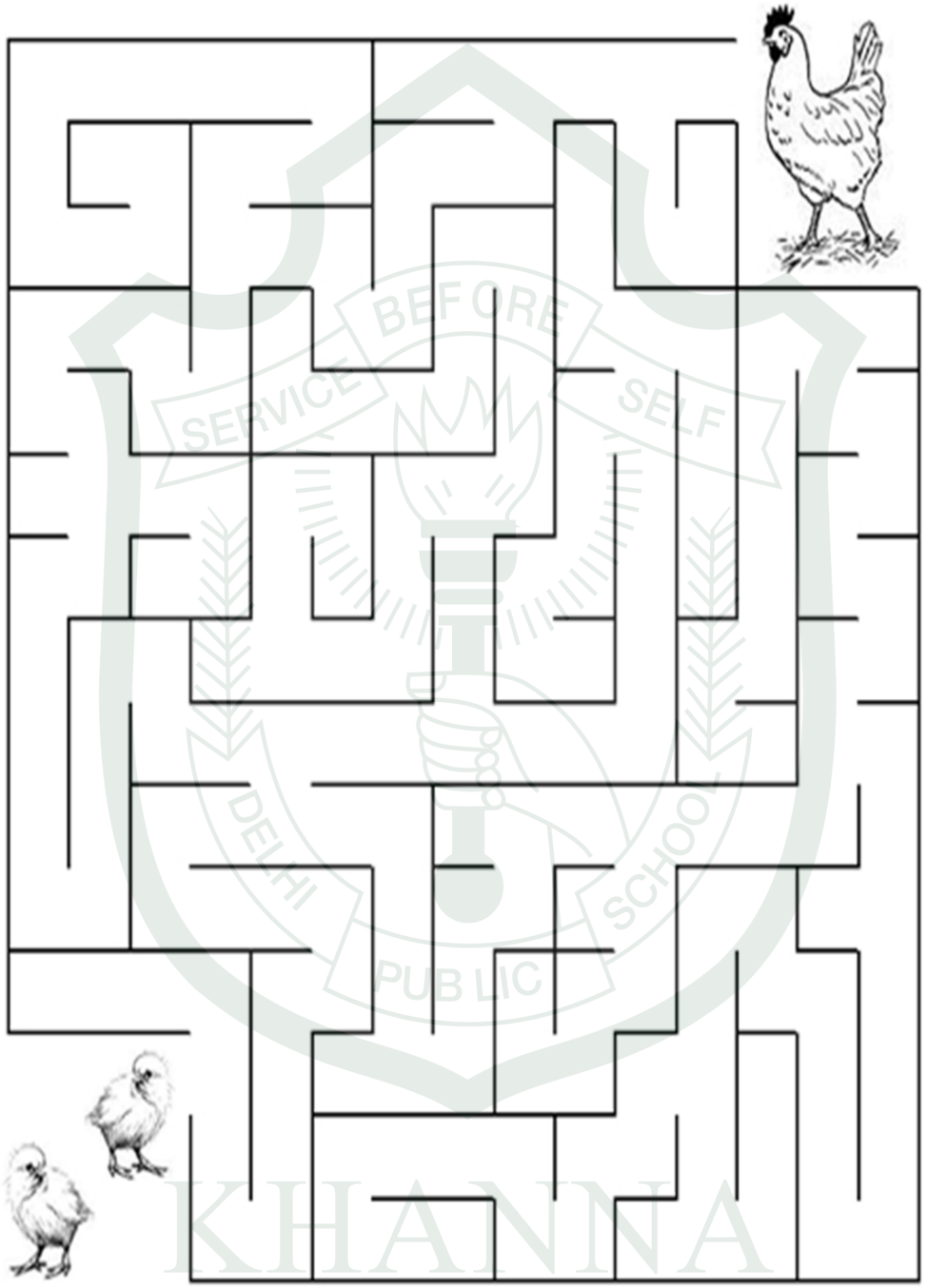

Punjabi

Section - A

1. ੳ – ਣ.

.....

.....

.....

.....

2. ਖਾਲੀ ਥਾਵਾਂ ਭਰੋ.

.....	ਅ	.....	ਸ	.....	
ਕ	.....	ਗ	ਘ	.....	
ਚ	.....	ਜ	ਝ	.....	
ਟ	.....	.....	ਢ	.....	

3. ਅੱਖਰ ਪੜ੍ਹਕੇ ਤਸਵੀਰ ਬਣਾਓ.

ਅ ਡ

ਛ ਖ

4. ਚਿੱਤਰ ਮਿਲਾਨ

ੳ

ਸ

ਚ



ਹ

5. ਤਸਵੀਰ ਦੇਖਕੇ ਪਹਿਲਾ ਅੱਖਰ ਲਿੱਖੋ

.....

.....

.....

Hindi

Section - A

1. vk b bi m dh ek=k d: 5-5 'kCn fy[k vkj i<k and read page no. 17,18,21,22,25,26,29,30 of text book.

vk	b	bi	m
.....	.....	.....	.....
.....	.....	.....	.....
.....	.....	.....	.....
.....	.....	.....	.....
.....	.....	.....	.....

KHANNA

16.

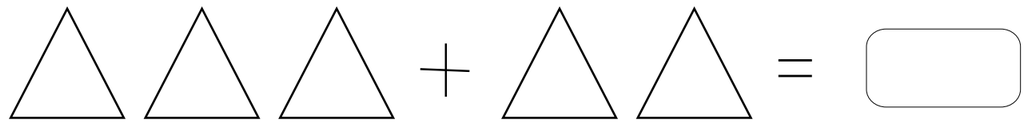

17. Tall/Short

a. Tick the taller person

b. Tick the shorter plant

18. Dodging tables.

(a)	2 × 5 =		(e)	5 × 3 =	
(b)	2 × 9 =		(f)	5 × 8 =	
©	4 × 4 =		(g)	10 × 5 =	
(d)	4 × 7 =		(h)	0 × 5 =	

KHANNA

3. Write the names of the following numerals.

a. 78 - .....

b. 100 - .....

c. 37 - .....

4. What comes before and after.

a. ☐ 46 ☐

b. ☐ 68 ☐

5. Circle the odd picture.

a.

b.

c.

6. Subtract the following:

a. T O

8
- 6
☐

b. T O

9
- 0
☐

c. T O

9
- 4
☐

d. T O

2
- 1
☐

7. Count the stars and tick the correct answer.



a. 6 ☐ b. 7 ☐ c. 8 ☐ d. 9 ☐

8. Complete the series.

1, 2, 3, 4, 5, 6, 7, ☐, 9, 10

20, 22, ☐, ☐, 28

35, 40, ☐, 50, ☐

9. How many days are there in 1 week?

10. 16 - 5 =

11. How many wheels are there in a bicycle?

a. 3 b. 2 c. 4

12. Is Sunday your holiday?

Yes No

13. January, February, …….. , April.

14. Colour the bigger smiley.

15. Heavy/Light

a. Tick the heavier animal

b. Tick the lighter object

Mathematics

Section - A

1. Add the following.

a.
T	O
4	3
+ 2	4

b.
T	O
5	8
+ 4	0

c.
T	O
2	0
+	9

2. Write sequence counting from 161 to 180.

H	T	O		H	T	O